SpaßLernFabrik
Arbeitsblatt zum Video „Die Zahlenhäuser"

Name: _____

Datum: _____

Durcheinander-Häuser ★★★

Hier sind die Stockwerke durcheinander. Frag dich: Wie viele fehlen bis zur Dachzahl?

So geht's:

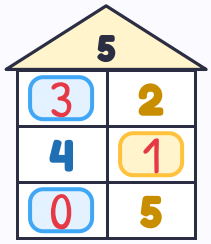

1

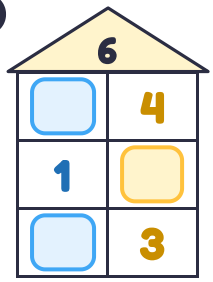

2

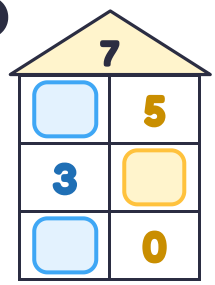

3



4

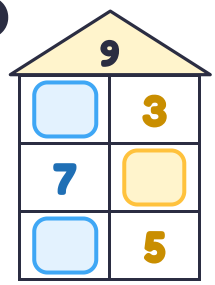

5

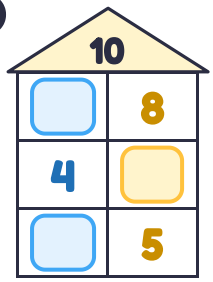

6



7

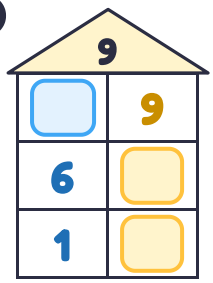

8



So ging es mir: ☺ 😐 ☹