SpaßLernFabrik

Arbeitsblatt zum Video „Die Zahlenhäuser"

Name: _____

Datum: _____

Wie viele blaue, wie viele gelbe? ★★★

Die Dachzahl sagt, wie viele Plättchen es zusammen sind. Zähle die blauen und die gelben Plättchen und schreibe sie ins Stockwerk.

So geht's:

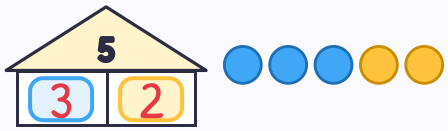

1

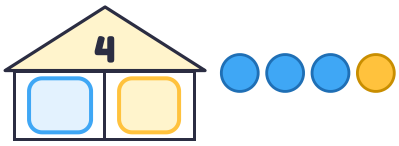

2

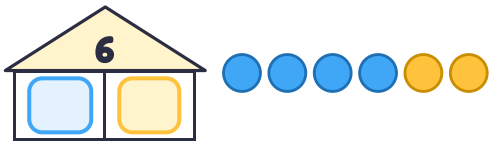

3

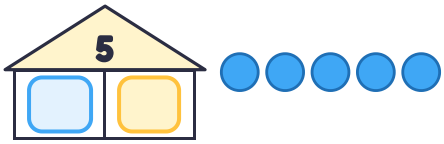

4

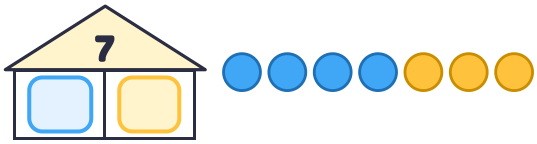

5

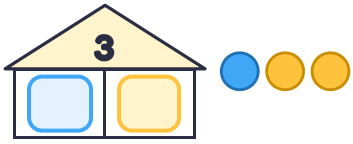

6



7

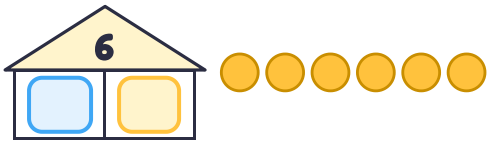

8



So ging es mir: ☺ 😐 ☹